Panora

EASY

Dinosaurs counting pictures

Name _____ Date _____

Count the pictures in each card and add. Use the number line to help.



3 + 0 = ____



4 + 2 = ____



2 + 0 = ____



3 + 0 = ____



3 + 1 = ____



3 + 1 = ____



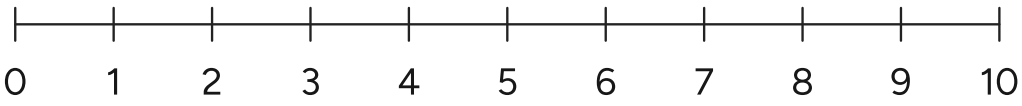





Love this? Meet **Little Explorers Science Adventure Activity Book**

www.panoraworlds.com/q/p-math-worksheets-dinosaurs-1/