Panora

EASY

Ocean counting pictures

Name _____ Date _____

Count the pictures in each card and add. Use the number line to help.



2 + 2 = ____



4 + 0 = ____



4 + 1 = ____



3 + 3 = ____



4 + 1 = ____



4 + 3 = ____



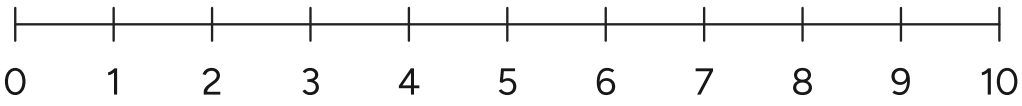





Love this? Meet **The Ocean Activity Book**

www.panoraworlds.com/q/p-math-worksheets-ocean-1/